MESURES : Estimer une mesure

M.2.J – Range les objets dans l'ordre croissant de leur masse.





M.2.O – Range les segments dans l'ordre croissant sans les mesurer.

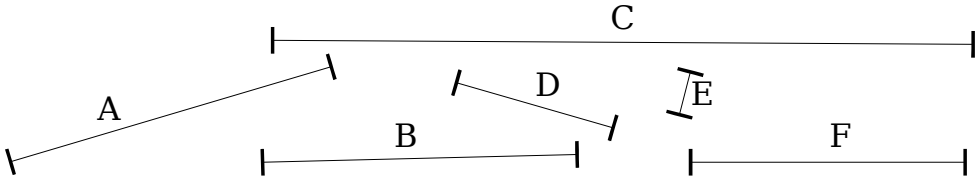

M.2.V – Relie chaque image à son unité de mesure.

. . . . . .

. . . . . .

kg cm cL g L m mL km

M.2.B – Relie chaque animal à l'estimation de sa masse.

. . . . . .

. . . . . .

3,5 kg 360 kg 260 kg 6 kg 165 tonnes 15 mg 100 mg 70 kg

M.2.M - Donne une estimation pour la mesure de chaque objet.



..... kg		 cL		..... kg		..... m		..... km	
..... kg		 cL		..... kg		..... m		..... km	
..... kg		 cL		..... kg		..... m		..... km	
..... kg		 cL		..... kg		..... m		..... km	
..... kg		 cL		..... kg		..... m		..... km	
..... kg		 cL		..... kg		..... m		..... km	
..... kg		 cL		..... kg		..... m		..... km	
..... kg		 cL		..... kg		..... m		..... km	
..... kg		 cL		..... kg		..... m		..... km	
..... kg		 cL		..... kg		..... m		..... km	